Contours droits et courbes

Suis chaque contour. Associe les formes à DROITS, COURBES ou AUX DEUX.

Prénom _____ Date _____

1 = droits 2 = courbes 3 = les deux

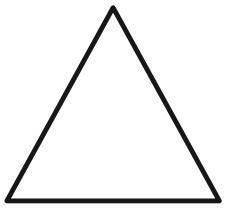









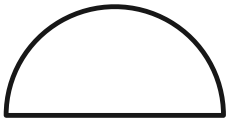





Contours droits et courbes

Suis chaque contour. Associe les formes à DROITS, COURBES ou AUX DEUX.

Prénom _____ Date _____

1 = droits 2 = courbes 3 = les deux

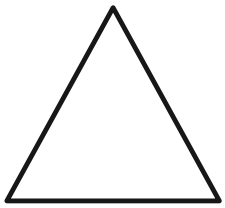

1



2



1

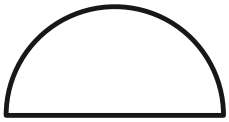

3