Une suite qui diminue

Observe les groupes d’étoiles. Dessine le suivant. Combien disparaissent chaque fois?

Prénom _____ Date _____

1 

2 

3 

4 

Chaque groupe perd un élément.

Une suite qui diminue

Observe les groupes d’étoiles. Dessine le suivant. Combien disparaissent chaque fois?

Prénom _____ Date _____

1 

2 

3 

4 

Chaque groupe perd un élément.