Un coup d’œil aux cadres de cinq

Observe chaque cadre. Encercle sa quantité. Compte pour vérifier si tu veux.

Prénom _____ Date _____



1 2 3 4 5



1 2 3 4 5



1 2 3 4 5



1 2 3 4 5

Un coup d’œil aux cadres de cinq

Observe chaque cadre. Encercle sa quantité. Compte pour vérifier si tu veux.

Prénom _____ Date _____



1 (2) 3 4 5



1 2 3 (4) 5



(1) 2 3 4 5



1 2 3 4 (5)