Bordes rectos y curvos

Recorre los contornos. Relaciona cada figura con RECTOS, CURVOS o AMBOS.

Nombre _____ Fecha _____

1 = rectos 2 = curvos 3 = ambos

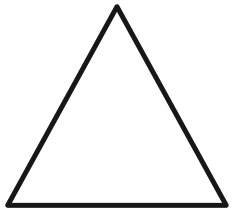















Bordes rectos y curvos

Recorre los contornos. Relaciona cada figura con RECTOS, CURVOS o AMBOS.

Nombre _____ Fecha _____

1 = rectos 2 = curvos 3 = ambos

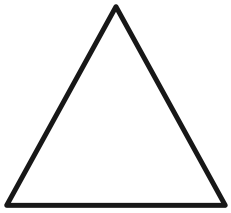

1



2



1

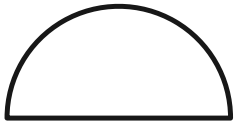

3