# Straight Edges and Curved Edges

Trace each outline. Match shapes to STRAIGHT, CURVED, or BOTH.

Name _____ Date _____

1 = straight 2 = curved 3 = both

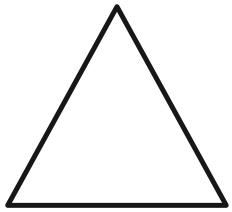















# Straight Edges and Curved Edges

Trace each outline. Match shapes to STRAIGHT, CURVED, or BOTH.

Name _____ Date _____

1 = straight 2 = curved 3 = both

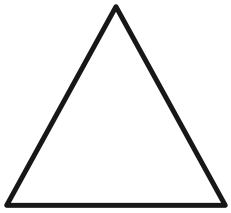

1



2



1

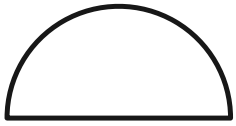

3