A Pattern That Shrinks

Look at the star groups. Draw the next group. How many disappear each time?

Name _____ Date _____

1 

2 

3 

4 

Each group loses one.

A Pattern That Shrinks

Look at the star groups. Draw the next group. How many disappear each time?

Name _____ Date _____

1 

2 

3 

4 

Each group loses one.