A Pattern That Grows

Look at the flower groups. Draw the next group and explain what changed.

Name _____ Date _____

1 

2 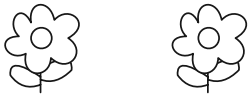

3 

4 ?

Each group gains one.

A Pattern That Grows

Look at the flower groups. Draw the next group and explain what changed.

Name _____ Date _____

1 

2 

3 

4 

Each group gains one.