A Quick Look at Five Frames

Look at each frame. Circle its quantity. Count to check when you want.

Name _____ Date _____



1 2 3 4 5



1 2 3 4 5



1 2 3 4 5



1 2 3 4 5

A Quick Look at Five Frames

Look at each frame. Circle its quantity. Count to check when you want.

Name _____ Date _____



1 (2) 3 4 5



1 2 3 (4) 5



(1) 2 3 4 5



1 2 3 4 (5)