Equal Groups: Count, Then Multiply

Name: _____ Date: _____

Practice sheet

Count groups and the dots in each group.

1



__ groups of __

__ × __ = __

2

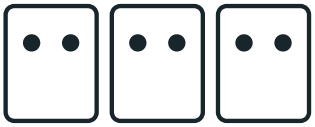

__ groups of __

__ × __ = __

3



__ groups of __

__ × __ = __

4



__ groups of __

__ × __ = __

5



__ groups of __

__ × __ = __

6

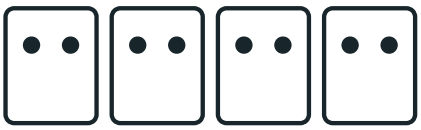

__ groups of __

__ × __ = __

Equal Groups: Count, Then Multiply · Answer key

Name: _____ Date: _____

Answer key

Count groups and the dots in each group.

1



2 groups of 3

2 × 3 = 6

2

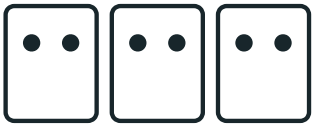

3 groups of 2

3 × 2 = 6

3



4 groups of 4

4 × 4 = 16

4



5 groups of 3

5 × 3 = 15

5



3 groups of 4

3 × 4 = 12

6

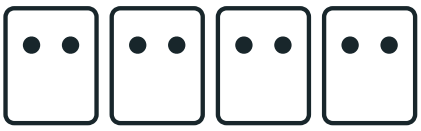

4 groups of 2

4 × 2 = 8